June 2020

Dear Parents of Soon to be Third Graders,

Attached you will find a math packet designed to review the skills that were learned in second grade while also becoming familiar with the common core standards for the third grade. As your child completes each problem they can color in the problem's corresponding check box at the bottom of the page. When all exercises are completed, they can color in the apple to show that they completed the page. This completed packet must be handed in by ~~FRIDAY~~, SEPT. 18TH and will count as your child's first math assessment grade of the trimester.

As always, thank you for your cooperation. Have a wonderful and safe summer. We look forward to an exciting year to come!!

Thank you.

Sincerely,

Mrs. Ritter and Mrs. McKee

Quick Common Core

Back to School

3rd grade



Name: _____

Introduction

Back to School Quick Common Core is a packet of ten different worksheets featuring a fun back to school theme. You can use one worksheet per day as a warm up to your daily classroom lesson. This packet is designed to meet the level of a beginning third grade student who is both reviewing those skills that were learned in the second grade while becoming familiar with the common core standards for the third grade.

As a student completes each problem they can color in the problem's corresponding checkbox at the bottom of the page, giving them a sense of accomplishment. Then, when all exercises are completed, either they or you can color in the apple at the bottom right hand corner of the page.

Visit mixminder.com for free worksheets and curriculum.

Back to School Quick Common Core

1 Ethan sharpened **510 pencils.** Then he sharpened **249 more.** How many pencils did Ethan sharpen in all?

_____ + _____ = _____



2

$$\begin{array}{r} 5 \\ \times 1 \\ \hline \end{array}$$

3 Round these numbers to the nearest tens:

47

91

4 **Add:**

$$\begin{array}{r} 87 \\ +21 \\ \hline \end{array} \qquad \begin{array}{r} 79 \\ +81 \\ \hline \end{array} \qquad \begin{array}{r} 135 \\ +54 \\ \hline \end{array}$$

5 Draw two different things that you think weigh about 1 kilogram.

6 <, >, or =

87 ◯ 88

167 ◯ 164

247 ◯ 247



Back to School Quick Common Core

Name: _____

1 Thomas and his mother went to the store to buy school supplies. They bought **72 items**, then found **84 more items** to buy. How many items did they buy in all?

_____ + _____ = _____

2 Draw the time **3:20 pm** on this clock?



3 Shade in 1/4 of this square.



4 Draw two different shapes that have 4 sides.

5 **Multiply:**

8	2	3
x1	x2	x2
____	____	____

6 Add 100 to the number below:

79

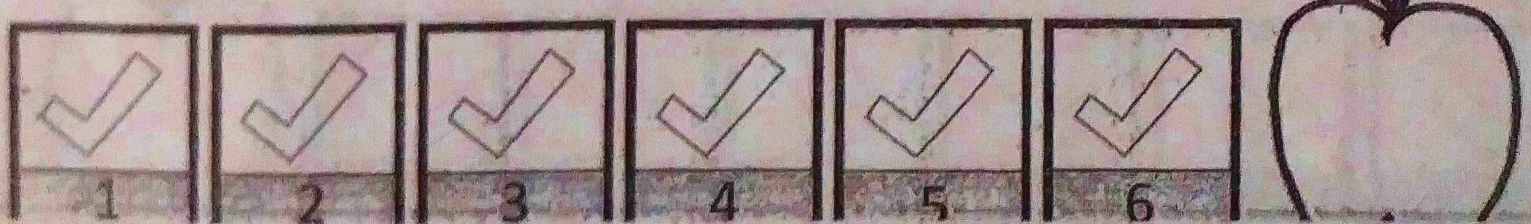

Back to School Quick Common Core

:_____

1 Mr. Douglas had 270 rulers. He gave each of the 85 students in the school **one ruler** each. How many rulers does he have left over?

_____ - _____ = _____

2 <,>, or =

229 ◯ 234

391 ◯ 243

602 ◯ 602

3 What shape has **2 sets of 2 equal sides?** Draw it below.

4 **Subtract:**

184	80	195
-85	-69	-86

5 How many **crayons** are in this box? Multiply that number by **2.**

Draw a picture to help you.



6 Shade in 1/2 of this triangle.

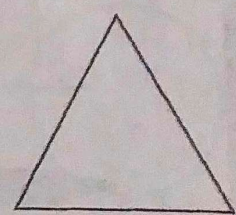

1 2 3 4 5 6



Back to School Quick Common Core

Name: _____

1 Sally Jean had **85 cents**. Draw **coins** that can equal 85 cents below.

2 Measure this **piece of paper** with your ruler. How **many centimeters** is the paper?

3 Draw the time 5:40 am on this clock?



4 How many tens and ones are in each number?

78 ____ tens ____ ones

65 ____ tens ____ ones

5 Nicholas brought **84 apples** to school for his class. He dropped **25 apples** on his way to school. How many does he have left?

____ - ____ = ____

6

$$\begin{array}{r} 3 \\ \times 2 \\ \hline \end{array}$$

1 2 3 4 5 6



1 120 students in the school have green backpacks and 92 students in the school have blue backpacks. How many backpacks are there in all?

____ + ____ = ____

2 223

Is this number

even

or

odd?

3 Use your ruler to measure your shoe. How long is it?

4 How much money is this? Two nickels, three pennies and two dimes. Draw pictures of the money to help you answer the question.

5 Mr. Brown bought his son a bottle of glue at the time shown on the clock. What time does the clock show?





6 Shade 1/4 of this circle.





Back to School Math Common Core

Name: _____

1 Fill in the **missing numbers**:

_____ , _____ ,15 , 20, _____

2

$$\begin{array}{r} 3 \\ \times 3 \\ \hline \end{array}$$

3 Shade 1/6 of this square.



4 Emily went school supply shopping with her mom. They started shopping at 4:30 and stopped shopping at 5:05? How much time passed while they shopped?

5 Draw this time on the clock:

2:05 PM

6 Write this number in **words**:

131



1 Multiply 7 by 2.

2 932 Is this number even or odd?

3 Shade in this circle to represent 1/2.

4 Cody had **616 pencils** sitting on his desk, but **183 pencils** rolled off the desk and fell on the ground. How many pencils are left on his desk?

____ - ____ = ____

5 **Multiply:**

8	6	1
x1	x0	x4
____	____	____

6 **<,>, or =**

1/3 ◯ 1/4

2/3 ◯ 1/8

1/4 ◯ 2/4



Back to School Quick Common Core

Name: _____

1 If Louis has **five nickels** and **three dimes**, how many **cents** does she have? Draw the money below.

2 What time does this clock show?

3 Draw a picture of something that you think equals ***one gram.***

4 Emma brought **92 apples** for the class. Ryan brought **65 apples** for the class. Nikki brought **27 apples** for the class. How many apples did the students bring in total?

_____ + _____ + _____ = _____

5 Multiply **2** by the number **9**.

6 Draw an example of a **quadrilateral.**



1 Read the time on the digital clock and then put that same time on the analog clock.

2 Add 100 to the number below:

193

3

$$\begin{array}{r} 4 \\ \times 3 \\ \hline \end{array}$$

4 Eva borrowed **87 books** from the school library. Then Eva borrowed **26 books** from the city library. Finally, Eva borrowed **180 books** from her friend. How many did Eva borrow in all?

____ + ____ + ____ = ____

5 Practice your skip counting by filling in the blanks below. Count by **5** starting with **35**.

35 ____ ____ ____ ____

6

$$\begin{array}{r} \square \\ \times 3 \\ \hline 3 \end{array}$$







Name: _____

1 **Multiply:**

2	1	6
x3	x4	x7
_____	_____	_____

2 Measure the **width** and **height** of your desk in centimeters.

3 Add **100** to the number below

487

4 Mrs. Hewitt brought in **717 treats** for her class. **608 treats** were eaten. How many treats were left?

_____ - _____ = _____

5 Practice your **skip counting** by filling in the blanks below. Count by **10**.

60 _____ _____ _____ _____

6 What **time** does this clock show?